PYQSide PYQSide.com — free PYQs with solutions Powered by TestBlink

JEE MAIN 2026 (ONLINE) 28TH JANUARY MORNING SHIFT

Question Paper · answer key at the end

Time: 3 Hours **Max. Marks:** 300 **Questions:** 75

General Instructions:

1. The duration of the paper is 3 hours. It has 75 questions: Physics 25, Chemistry 25, Mathematics 25.
2. Each subject has Section A (multiple-choice questions, only one correct answer) and Section B (numerical-value questions).
3. Marking: +4 for each correct answer, −1 for each wrong answer, 0 for a question not answered.
4. The answer key is at the end. Scan the QR code beside any question for its step-by-step solution.
5. Practise this paper as a timed test on the real exam screen, free, at pyqside.com.

Section A (MCQ) — 60 questions

Q.1 Two circular discs of radius each 10 cm are joined at their centres by a rod of length 30 cm and mass 600 gm as shown in figure.
If the mass of each disc is 600 gm and applied torque between two discs is 43×10^5 dyne.cm, the angular acceleration of the discs about the given axis AB is _____ rad/s^2.

[JEE Main 2026 (Online) 28th January Morning Shift]

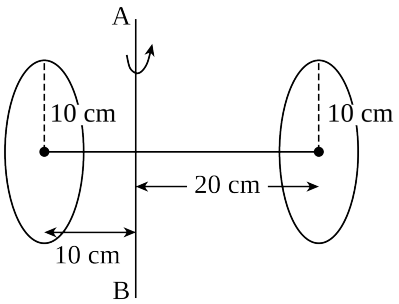

(1) 100 (2) 22 (3) 27 (4) 11

Scan or tap for the full solution

Q.2 Which of the following best represents the temperature versus heat supplied graph for water, in the range of −20°C to 120°C?

[JEE Main 2026 (Online) 28th January Morning Shift]

(1)
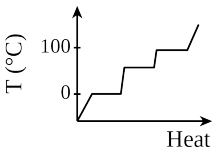

(2)
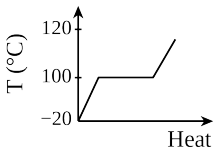

(3)
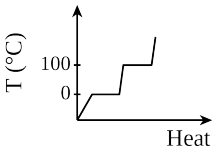

(4)
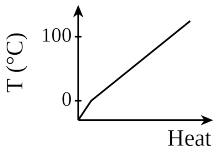

Scan or tap for the full solution

Q.3 Assuming in forward bias condition there is a voltage drop of 0.7 V across a silicon diode, the current through diode D_1 in the circuit is _____ mA.
(Assume all diodes in the given circuit are identical)

[JEE Main 2026 (Online) 28th January Morning Shift]

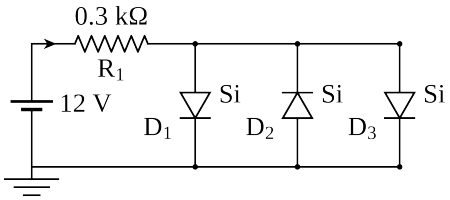

(1) 17.6 (2) 18.8 (3) 20.15 (4) 11.7

Scan or tap for the full solution

Q.4 The electric current in the circuit is given as $i = i_o(t/T)$. The r.m.s current for the period t = 0 to t = T is _____ .

[JEE Main 2026 (Online) 28th January Morning Shift]

(1) $\frac{i_o}{\sqrt{2}}$ (2) $\frac{i_o}{\sqrt{3}}$ (3) i_o (4) $\frac{i_o}{\sqrt{6}}$

Scan or tap for the full solution

Q.5 A block of mass 5 kg is moving on an inclined plane which makes an angle of 30° with the horizontal. Friction coefficient between the block and inclined plane surface is $\frac{\sqrt{3}}{2}$. The force to be applied on the block so that the block will move down without acceleration is _____ N.
(g = 10 m/s^2).

[JEE Main 2026 (Online) 28th January Morning Shift]

(1) 25 (2) 12.5 (3) 15 (4) 7.5

Scan or tap for the full solution

Q.6 A particle of mass m falls from rest through a resistive medium having resistive force, F = −kv, where v is the velocity of the particle and k is a constant. Which of the following graphs represents velocity (v) versus time (t) ?

[JEE Main 2026 (Online) 28th January Morning Shift]

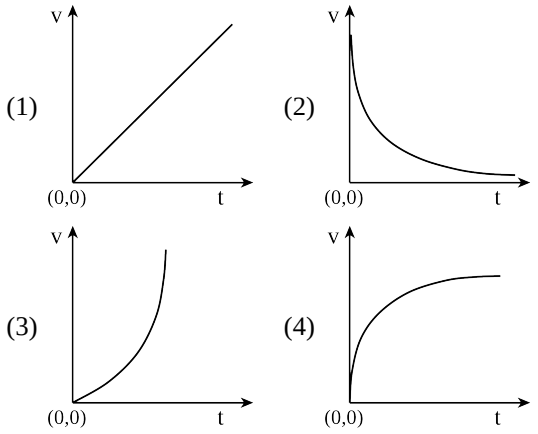

Scan or tap for the full solution

Q.7 An atom $^{8}_{3}X$ is bombarded by shower of fundamental particles and in 10 s this atom absorbed 10 electrons, 10 protons and 9 neutrons. The percentage growth in the surface area of the nucleus is recorded by :

[JEE Main 2026 (Online) 28th January Morning Shift]

(1) 150% (2) 900% (3) 125% (4) 225%

Scan or tap for the full solution

Q.8 When both jaws of vernier callipers touch each other, zero mark of the vernier scale is right to zero mark of main scale, 4th mark on vernier scale coincides with certain mark on the main scale. While measuring the length of a cylinder, observer observes 15 divisions on main scale and 5th division of vernier scale coincides with a main scale division. Measured length of cylinder is ____ mm.
(Least count of Vernier calliper = 0.1 mm)

[JEE Main 2026 (Online) 28th January Morning Shift]

(1) 15.5 (2) 15.4 (3) 15.9 (4) 15.1

Scan or tap for the full solution

Q.9 The magnetic field at the centre of a current carrying circular loop of radius R is 16 μT. The magnetic field at a distance $x = \sqrt{3}R$ on its axis from the centre is ____ μT.

[JEE Main 2026 (Online) 28th January Morning Shift]

(1) 8 (2) 2 (3) 4 (4) $2\sqrt{2}$

Scan or tap for the full solution

Q.10 Three long straight wires carrying current are arranged mutually parallel as shown in the figure. The force experienced by 15 cm length of wire Q is ____.
($\mu_0 = 4\pi \times 10^{-7}$ T m/A)

[JEE Main 2026 (Online) 28th January Morning Shift]

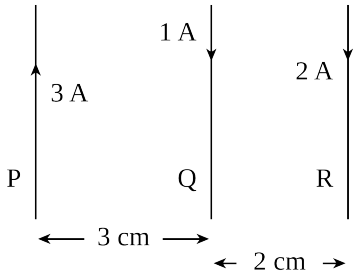

(1) 6×10^{-6} N towards P (2) 6×10^{-6} N towards R
(3) 6×10^{-7} N towards P (4) 6×10^{-7} N towards R

Scan or tap for the full solution

Q.11 The magnitudes of power of a biconvex lens (refractive index 1.5) and that of a plano-concave lens (refractive index = 1.7) are same. If the curvature of plano-concave lens exactly matches with the curvature of back surface of the biconvex lens, then ratio of radius of curvature of front and back surface of the biconvex lens is ____

[JEE Main 2026 (Online) 28th January Morning Shift]

(1) 2:5 (2) 5:2 (3) 12:5 (4) 5:12

Scan or tap for the full solution

Q.12 The electric field of an electromagnetic wave travelling through a medium is given by $\vec{E}(x, t) = 25\sin(2.0 \times 10^{15}t - 10^{7}x)\hat{n}$ then the refractive index of the medium is ____.
(All given measurements are in SI units)

[JEE Main 2026 (Online) 28th January Morning Shift]

(1) 2 (2) 1.2 (3) 1.5 (4) 1.7

Scan or tap for the full solution

Q.13 Water drops fall from a tap on the floor, 5 m below, at regular intervals of time, the first drop strikes the floor when the sixth drop begins to fall. The height at which the fourth drop will be from ground, at the instant when the first drop strikes the ground is ____ m.
($g = 10$ m/s^2)

[JEE Main 2026 (Online) 28th January Morning Shift]

(1) 3.8 (2) 4.0 (3) 4.2 (4) 2.5

Scan or tap for the full solution

Q.14 For the two cells having same EMF E and internal resistance r, the current passing through the external resistor 6 Ω is same when both the cells are connected either in parallel or in series. The value of internal resistance r is ____ Ω.

[JEE Main 2026 (Online) 28th January Morning Shift]

(1) 3 (2) 6 (3) 4 (4) 9

Scan or tap for the full solution

Q.15 10 kg of ice at −10 °C is added to 100 kg of water to lower its temperature from 25 °C. Consider no heat exchange to surroundings. The decrement to the temperature of water is ____ °C.
(specific heat of ice = 2100 J/kg °C, specific heat of water = 4200 J/kg °C, latent heat of fusion of ice = 3.36×10^5 J/kg)

[JEE Main 2026 (Online) 28th January Morning Shift]

(1) 15 (2) 10 (3) 6.67 (4) 11.6

Scan or tap for the full solution

Q.16 Two point charges of 1 nC and 2 nC are placed at the two corners of equilateral triangle of side 3 cm. The work done in bringing a charge of 3 nC from infinity to the third corner of the triangle is ____ μJ.

$\frac{1}{4\pi\varepsilon_0} = 9 \times 10^9\ \text{N m}^2/\text{C}^2$

[JEE Main 2026 (Online) 28th January Morning Shift]

(1) 3.3 (2) 27 (3) 2.7 (4) 5.4

Scan or tap for the full solution

Q.17 Given below are two statements :
Statement-I: A plane wave after passing through prism remains as plane wave but passing through small pin hole may become spherical wave.
Statement-II: The curvature of a spherical wave emerging from a slit will increase for increasing slit width.

In the light of the above statements, choose the correct answer from the options given below :

[JEE Main 2026 (Online) 28th January Morning Shift]

(1) Both Statement-I and Statement-II are false
(2) Both Statement-I and Statement-II are true
(3) Statement-I is true but Statement-II is false
(4) Statement-I is false but Statement-II is true

Scan or tap for the full solution

Q.18 In the potentiometer, when the cell in the secondary circuit is shunted with 4 Ω resistance, the balance is obtained at the length 120 cm of wire. Now when the same cell is shunted with 12 Ω resistance, the balance is shifted to a length of 180 cm. The internal resistance of cell is ____ Ω

[JEE Main 2026 (Online) 28th January Morning Shift]

(1) 4 (2) 12 (3) 6 (4) 3

Scan or tap for the full solution

Q.19 Two wires A and B made of different materials of lengths 6.0 cm and 5.4 cm, respectively and area of cross sections 3.0×10^{-5} m^2 and 4.5×10^{-5} m^2, respectively are stretched by the same magnitude under a given load. The ratio of the Young's modulus of A to that of B is x:3. The value of x is ____

[JEE Main 2026 (Online) 28th January Morning Shift]

(1) 2 (2) 1 (3) 4 (4) 5

Scan or tap for the full solution

Q.20 In the following p − V diagram the equation of state along the curved path is given by $(V - 2)^2 = 4ap$ where a is a constant. The total work done in the closed path is

[JEE Main 2026 (Online) 28th January Morning Shift]

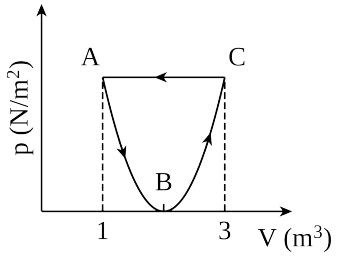

(1) $+\frac{1}{3a}$ (2) $-\frac{1}{a}$ (3) $\frac{1}{2a}$ (4) $-\frac{1}{3a}$

Scan or tap for the full solution

Q.21 Given below are two statements :
Statement-I: The number of pairs, from the following, in which both the ions are coloured in aqueous solution is 3.
[Sc^{3+}, Ti^{3+}], [Mn^{2+}, Cr^{2+}], [Cu^{2+}, Zn^{2+}] and [Ni^{2+}, Ti^{4+}]
Statement-II: Th^{4+} is the strongest reducing agent among Th^{4+}, Ce^{4+}, Gd^{3+} and Eu^{2+}.

In the light of the above statements, choose the correct answer from the options given below

[JEE Main 2026 (Online) 28th January Morning Shift]

(1) Statement-I is false but Statement-II is true
(2) Both Statement-I and Statement-II are false
(3) Both Statement-I and Statement-II are true
(4) Statement-I is true but Statement-II is false

Scan or tap for the full solution

Q.22 20.0 dm^3 of an ideal gas 'X' at 600 K and 0.5 MPa undergoes isothermal reversible expansion until pressure of the gas is 0.2 MPa. Which of the following option is correct?
(Given: $\log 2 = 0.3010$ and $\log 5 = 0.6989$)

[JEE Main 2026 (Online) 28th January Morning Shift]

(1) w = −9.1 kJ, ΔU = 0, ΔH = 0, q = 9.1 kJ
(2) w = 9.1 J, ΔU = 9.1 J, ΔH = 0; q = 0
(3) w = −3.9 kJ, ΔU = 0, ΔH = 0; q = 3.9 kJ
(4) w = + 4.1 kJ, ΔU = 0, ΔH = 0; q = −4.1 kJ

Scan or tap for the full solution

Q.23 In period 4 of the periodic table, the elements with highest and lowest atomic radii are respectively.

[JEE Main 2026 (Online) 28th January Morning Shift]

(1) Rb & Br (2) Na & Cl (3) K & Br (4) K & Se

Scan or tap for the full solution

Q.24 Method used for separation of mixture of products (B and C) obtained in the following reaction is

[JEE Main 2026 (Online) 28th January Morning Shift]

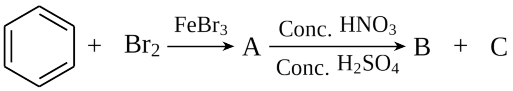

(1) simple distillation (2) sublimation
(3) fractional distillation (4) steam distillation

Scan or tap for the full solution

Q.25 Regarding the hydrides of group 15 elements EH_3 (E = N, P, As, Sb), select the correct statement from the following :

A. The stability of hydrides decreases down the group.
B. The basicity of hydrides decreases down the group.
C. The reducing character increases down the group.
D. The boiling point increases down the group.

Choose the correct answer from the options given below :

[JEE Main 2026 (Online) 28th January Morning Shift]

(1) A, B & C only (2) A, B, C & D
(3) A & D only (4) B & C only

Scan or tap for the full solution

Q.26 Given below are two statements for the following reaction sequence.

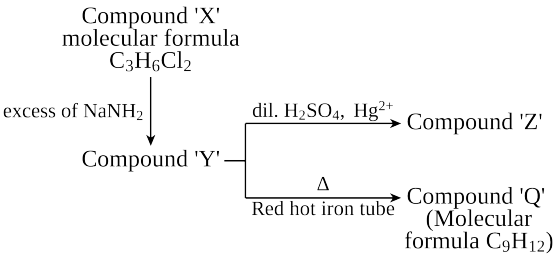

Statement-I: Compound 'Z' will give yellow precipitate with NaOI.

Statement-II: Compound 'Q' has two different types of 'H' atoms (aromatic : aliphatic) in the ratio 1:3.

In the light of the above statements, choose the **correct** answer from the options given below :

[JEE Main 2026 (Online) 28th January Morning Shift]

(1) Statement-I is true but Statement-II is false
(2) Both Statement-I and Statement-II are true
(3) Statement-I is false but Statement-II is true
(4) Both Statement-I and Statement-II are false

Scan or tap for the full solution

Q.27 $Ph–CH=CH_2 \xrightarrow[HBr]{(PhCOO)_2}$ Product

Consider the above reaction

A. The reaction proceeds through a more stable radical intermediate.
B. The role of peroxide is to generate $H^{\cdot}$ (Hydrogen radical).
C. During this reaction, benzene is formed as a byproduct.
D. 1-Bromo-2-phenylethane is formed as the minor product.
E. The same reaction in absence of peroxide proceeds via carbocation intermediate.

Identify the correct statements.

Choose the correct answer from the options given below :

[JEE Main 2026 (Online) 28th January Morning Shift]

(1) A & E Only (2) A, B & D Only
(3) A, C & E Only (4) C, D & E Only

Scan or tap for the full solution

Q.28 An organic compound undergoes first order decomposition. The time taken for decomposition to $\left(\frac{1}{8}\right)^{th}$ and $\left(\frac{1}{10}\right)^{th}$ of its initial concentration are $t_{1/8}$ and $t_{1/10}$ respectively.

What is the value of $\frac{t_{1/8}}{t_{1/10}} \times 10$?

$(\log 2 = 0.3)$

[JEE Main 2026 (Online) 28th January Morning Shift]

(1) 30 (2) 9 (3) 3 (4) 0.9

Scan or tap for the full solution

Q.29 In the given pentapeptide, find out an essential amino acid (Y) and the sequence present in the pentapeptide :

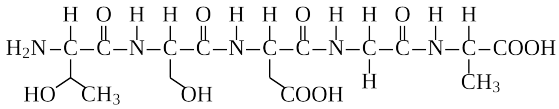

Choose the correct answer from the options given below :

[JEE Main 2026 (Online) 28th January Morning Shift]

	(Y)	(Sequence)
(1)	Serine	Thr–Ser–Asp–Ala–Gly
(2)	Serine	Ser–Asp–Thr–Ala–Gly
(3)	Threonine	Ser–Thr–Asp–Gly–Ala
(4)	Threonine	Thr–Ser–Asp–Gly–Ala

Scan or tap for the full solution

Q.30 At T(K), 2 moles of liquid A and 3 moles of liquid B are mixed. The vapour pressure of ideal solution formed is 320 mm Hg. At this stage, one mole of A and one mole of B are added to the solution. The vapour pressure is now measured as 328.6 mm Hg. The vapour pressure (in mm Hg) of A and B are respectively:

[JEE Main 2026 (Online) 28th January Morning Shift]

(1) 400, 300 (2) 600, 400
(3) 500, 200 (4) 300, 200

Scan or tap for the full solution

Q.31 The wave numbers of three spectral lines of H atom are considered. Identify the set of spectral lines belonging to Balmer series.
(R = Rydberg constant)

[JEE Main 2026 (Online) 28th January Morning Shift]

(1) $\frac{5R}{36}, \frac{3R}{16}, \frac{21R}{100}$ (2) $\frac{7R}{144}, \frac{3R}{16}, \frac{16R}{255}$
(3) $\frac{3R}{4}, \frac{3R}{16}, \frac{7R}{144}$ (4) $\frac{5R}{36}, \frac{8R}{9}, \frac{15R}{16}$

Scan or tap for the full solution

Q.32 Consider the following reaction sequence :

$$\text{Compound (x) [76.6\% C, 6.38\% H, vapour density 47]} \xrightarrow[\text{(ii) } H_3O^+]{\text{(i) } CO_2\text{, NaOH, 120°C, high pressure}} \text{Compound (y) (Major Product)}$$

Compound (y) develops characteristic colour with neutral $FeCl_3$ solution.
Identify the **INCORRECT** statement from the following for the above sequence.

[JEE Main 2026 (Online) 28th January Morning Shift]

(1) Compound y will dissolve in $NaHCO_3$ and evolve a gas.
(2) Compound x is more acidic than compound y.
(3) Both compounds x and y will dissolve in NaOH.
(4) Both compounds x and y will burn with sooty flame.

Scan or tap for the full solution

Q.33 CORRECT order of stability for the following is
$CH_2{=}CH^-$, $CH_3{-}CH_2^-$, $CH{\equiv}C^-$

[JEE Main 2026 (Online) 28th January Morning Shift]

(1) $CH{\equiv}C^- > CH_3{-}CH_2^- > CH_2{=}CH^-$
(2) $CH_2{=}CH^- > CH{\equiv}C^- > CH_3{-}CH_2^-$
(3) $CH{\equiv}C^- > CH_2{=}CH^- > CH_3{-}CH_2^-$
(4) $CH_3{-}CH_2^- > CH_2{=}CH^- > CH{\equiv}C^-$

Scan or tap for the full solution

Q.34

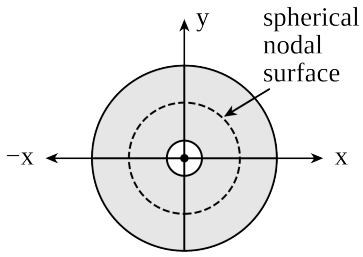

Figure 1. electron probability density for 2s orbital

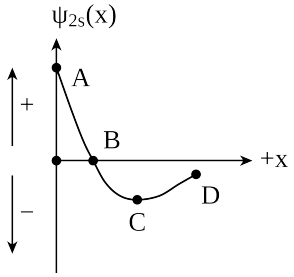

Figure 2. wave function for 2s orbital

Which of the following point in Figure 2 most accurately represents the nodal surface as shown in Figure 1?

[JEE Main 2026 (Online) 28th January Morning Shift]

(1) D (2) B (3) C (4) A

Scan or tap for the full solution

Q.35 Given below are the four isomeric compounds (P, Q, R, S)

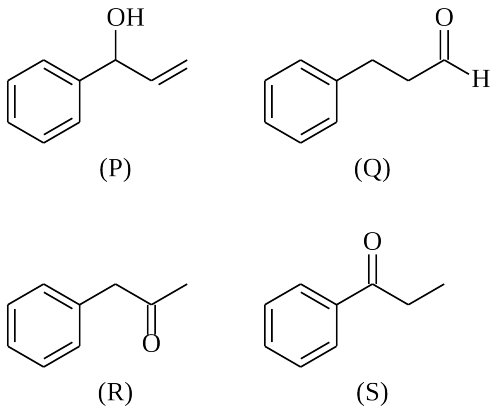

Identify correct statements from below.

A. Q, R and S will give precipitate with 2,4-DNP.
B. P and Q will give positive Baeyer's test.
C. Q and R will give sooty flame.
D. R and S will give yellow precipitate with I_2/NaOH.
E. Q alone will deposit silver with Tollens' reagent.

Choose the correct option.

[JEE Main 2026 (Online) 28th January Morning Shift]

(1) C and E only (2) A and E only

(3) A, B, D and E only (4) A, C and E only

Scan or tap for the full solution

Q.36 Consider a weak base 'B' of $pK_b = 5.699$. 'x' mL of 0.02 M HCl and 'y' mL of 0.02 M weak base 'B' are mixed to make 100 mL of a buffer of pH 9 at 25°C. The values of 'x' and 'y' respectively are :

[Given : $\log 2 = 0.3010$, $\log 3 = 0.4771$, $\log 5 = 0.699$]

[JEE Main 2026 (Online) 28th January Morning Shift]

	x	y		x	y
(1)	42.7	57.3	(2)	14.3	85.7
(3)	85.7	14.3	(4)	11.1	88.9

Scan or tap for the full solution

Q.37 Given below are two statements:

Statement-I: Griess-Ilosvay test is used for the detection of nitrite ion, which involves the use of sulphanilic acid and α-naphthylamine reagent.

Statement-II: In the above test, sulphanilic acid is diazotized by the acidified nitrite ion, which on further coupling with α-naphthylamine forms an azo-dye.

In the light of the above statements, choose the correct answer from the options given below

[JEE Main 2026 (Online) 28th January Morning Shift]

(1) Statement-I is true but Statement-II is false

(2) Both Statement-I and Statement-II are false

(3) Statement-I is false but Statement-II is true

(4) Both Statement-I and Statement-II are true

Scan or tap for the full solution

Q.38 Consider the following reactions giving major product. Identify the correct reaction.

[JEE Main 2026 (Online) 28th January Morning Shift]

(1)

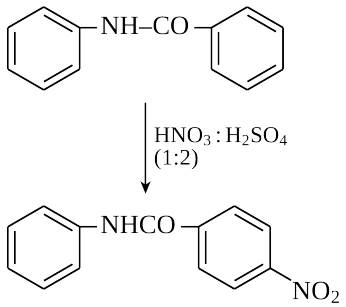

(2)

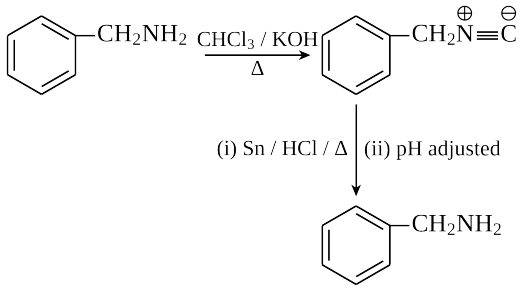

(3)

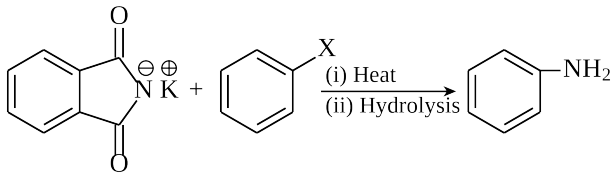

(4) $H_3CCH_2-\overset{O}{\overset{\|}{C}}-NH_2 + Br_2 + 4\ KOH\ (alc) \xrightarrow{\Delta} H_3CCH_2NH_2$

Scan or tap for the full solution

Q.39 The correct statement among the following is:

[JEE Main 2026 (Online) 28th January Morning Shift]

(1) $[Ni(CN)_4]^{2-}$ and $[NiCl_4]^{2-}$ are diamagnetic and $Ni(CO)_4$ is paramagnetic.

(2) $Ni(CO)_4$ is diamagnetic and $[NiCl_4]^{2-}$ and $[Ni(CN)_4]^{2-}$ are paramagnetic.

(3) $Ni(CO)_4$ and $[NiCl_4]^{2-}$ are diamagnetic and $[Ni(CN)_4]^{2-}$ is paramagnetic.

(4) $Ni(CO)_4$ and $[Ni(CN)_4]^{2-}$ are diamagnetic and $[NiCl_4]^{2-}$ is paramagnetic.

Scan or tap for the full solution

Q.40 Given below are two statements :

Statement-I: The number of species among BF_4^-, SiF_4, XeF_4 and SF_4, that have unequal E–F bond lengths is two. Here, E is the central atom.

Statement-II: Among O_2^-, O_2^{2-}, F_2 and O_2^+, O_2^- has the highest bond order.

In the light of the above statements, choose the correct answer from the options given below

[JEE Main 2026 (Online) 28th January Morning Shift]

(1) Both Statement-I and Statement-II are false

(2) Statement-I is true but Statement-II is false

(3) Statement-I is false but Statement-II is true

(4) Both Statement-I and Statement-II are true

Scan or tap for the full solution

Q.41 The area of the region $R = \{(x, y): xy \le 8,\ 1 \le y \le x^2,\ x \ge 0\}$ is

[JEE Main 2026 (Online) 28th January Morning Shift]

(1) $\frac{2}{3}(20\log_e(2)+9)$ (2) $\frac{1}{3}(40\log_e(2)+27)$

(3) $\frac{1}{3}(49\log_e(2)-15)$ (4) $\frac{2}{3}(24\log_e(2)-7)$

Scan or tap for the full solution

Q.42 If $g(x) = 3x^2 + 2x - 3$, $f(0) = -3$ and $4g(f(x)) = 3x^2 - 32x + 72$, then $f(g(2))$ is equal to:

[JEE Main 2026 (Online) 28th January Morning Shift]

(1) $\frac{7}{2}$ (2) $-\frac{25}{6}$ (3) $\frac{25}{6}$ (4) $-\frac{7}{2}$

Scan or tap for the full solution

Q.43 A bag contains 10 balls out of which k are red and $(10 - k)$ are black, where $0 \le k \le 10$. If three balls are drawn at random without replacement and all of them are found to be black, then the probability that the bag contains 1 red and 9 black balls is:

[JEE Main 2026 (Online) 28th January Morning Shift]

(1) $\frac{7}{110}$ (2) $\frac{7}{11}$ (3) $\frac{7}{55}$ (4) $\frac{14}{55}$

Scan or tap for the full solution

Q.44 The mean and variance of 10 observations are 9 and 34.2, respectively. If 8 of these observations are 2, 3, 5, 10, 11, 13, 15, 21, then the mean deviation about the median of all the 10 observations is

[JEE Main 2026 (Online) 28th January Morning Shift]

(1) 7 (2) 4 (3) 5 (4) 6

Scan or tap for the full solution

Q.45 If α, β, where $\alpha < \beta$, are the roots of the equation $\lambda x^2 - (\lambda + 3)x + 3 = 0$ such that $\frac{1}{\alpha} - \frac{1}{\beta} = \frac{1}{3}$, then the sum of all possible values of λ is

[JEE Main 2026 (Online) 28th January Morning Shift]

(1) 2 (2) 6 (3) 8 (4) 4

Scan or tap for the full solution

Q.46 Let $y = x$ be the equation of a chord of the circle C_1 (in the closed half-plane $x \ge 0$) of diameter 10 passing through the origin. Let C_2 be another circle described on the given chord as its diameter. If the equation of the chord of the circle C_2, which passes through the point (2, 3) and is farthest from the center of C_2, is $x + ay + b = 0$, then $a - b$ is equal to

[JEE Main 2026 (Online) 28th January Morning Shift]

(1) −6 (2) 10 (3) 6 (4) −2

Scan or tap for the full solution

Q.47 Let $S = \{x^3 + ax^2 + bx + c : a, b, c \in \mathbb{N}$ and $a, b, c \le 20\}$ be a set of polynomials. Then the number of polynomials in S, which are divisible by $x^2 + 2$, is

[JEE Main 2026 (Online) 28th January Morning Shift]

(1) 6 (2) 120 (3) 20 (4) 10

Scan or tap for the full solution

Q.48 Let A, B and C be three 2×2 matrices with real entries such that $B = (I + A)^{-1}$ and $A + C = I$.

If $BC = \begin{bmatrix} 1 & -5 \\ -1 & 2 \end{bmatrix}$ and $CB\begin{bmatrix} x_1 \\ x_2 \end{bmatrix} = \begin{bmatrix} 12 \\ -6 \end{bmatrix}$, then $x_1 + x_2$ is

[JEE Main 2026 (Online) 28th January Morning Shift]

(1) 4 (2) 2 (3) 0 (4) −2

Scan or tap for the full solution

Q.49 Let ABC be an equilateral triangle with orthocenter at the origin and the side BC on the line $x + 2\sqrt{2}y = 4$. If the co-ordinates of the vertex A are (α, β), then the greatest integer less than or equal to $|\alpha + \sqrt{2}\beta|$ is

[JEE Main 2026 (Online) 28th January Morning Shift]

(1) 5 (2) 4 (3) 2 (4) 3

Scan or tap for the full solution

Q.50 Let f be a polynomial function such that $f(x^2 + 1) = x^4 + 5x^2 + 2$, for all $x \in \mathbb{R}$.

Then $\int_0^3 f(x)\,dx$ is equal to

[JEE Main 2026 (Online) 28th January Morning Shift]

(1) $\frac{33}{2}$ (2) $\frac{5}{3}$ (3) $\frac{27}{2}$ (4) $\frac{41}{3}$

Scan or tap for the full solution

Q.51 If $\int\left(\frac{1-5\cos^2 x}{\sin^5 x\cos^2 x}\right)dx = f(x) + C$, where C is the constant of integration, then $f\left(\frac{\pi}{6}\right) - f\left(\frac{\pi}{4}\right)$ is equal to

[JEE Main 2026 (Online) 28th January Morning Shift]

(1) $\frac{1}{\sqrt{3}}(26-\sqrt{3})$ (2) $\frac{4}{\sqrt{3}}(8-\sqrt{6})$

(3) $\frac{1}{\sqrt{3}}(26+\sqrt{3})$ (4) $\frac{2}{\sqrt{3}}(4+\sqrt{6})$

Scan or tap for the full solution

Q.52 Let z be a complex number such that $|z - 6| = 5$ and $|z + 2 - 6i| = 5$. Then the value of $z^3 + 3z^2 - 15z + 141$ is equal to :

[JEE Main 2026 (Online) 28th January Morning Shift]

(1) 61 (2) 37 (3) 42 (4) 50

Scan or tap for the full solution

Q.53 The value of $\sum_{k=1}^{\infty}(-1)^{k+1}\left(\frac{k(k+1)}{k!}\right)$ is

[JEE Main 2026 (Online) 28th January Morning Shift]

(1) e/2 (2) $\sqrt{e}$ (3) 2/e (4) 1/e

Scan or tap for the full solution

Q.54 The common difference of the A.P.: $a_1, a_2, \ldots, a_m$ is 13 more than the common difference of the A.P.: $b_1, b_2, \ldots, b_n$. If $b_{31} = -277$, $b_{43} = -385$ and $a_{78} = 327$, then a_1 is equal to

[JEE Main 2026 (Online) 28th January Morning Shift]

(1) 21 (2) 19 (3) 24 (4) 16

Scan or tap for the full solution

Q.55 The value of

$$\lim_{x \to 0} \frac{\log_e(\sec(ex)\cdot\sec(e^2x)\cdot\ldots\cdot\sec(e^{10}x))}{e^2 - e^{2\cos x}}$$

is equal to

[JEE Main 2026 (Online) 28th January Morning Shift]

(1) $\frac{(e^{10}-1)}{2e^2(e^2-1)}$ (2) $\frac{(e^{20}-1)}{2e^2(e^2-1)}$

(3) $\frac{(e^{10}-1)}{2(e^2-1)}$ (4) $\frac{(e^{20}-1)}{2(e^2-1)}$

Scan or tap for the full solution

Q.56 Let S = {1, 2, 3, 4, 5, 6, 7, 8, 9}. Let x be the number of 9-digit numbers formed using the digits of the set S such that only one digit is repeated and it is repeated exactly twice. Let y be the number of 9-digit numbers formed using the digits of the set S such that only two digits are repeated and each of these is repeated exactly twice. Then,

[JEE Main 2026 (Online) 28th January Morning Shift]

(1) 56x = 9y (2) 21x = 4y

(3) 45x = 7y (4) 29x = 5y

Scan or tap for the full solution

Q.57 Let y = y(x) be the solution of the differential equation

$$x\frac{dy}{dx} - \sin 2y = x^3(2 - x^3)\cos^2 y,\ x \neq 0.$$

If y(2) = 0, then tan(y(1)) is equal to

[JEE Main 2026 (Online) 28th January Morning Shift]

(1) $-\frac{7}{4}$ (2) $-\frac{3}{4}$ (3) $\frac{3}{4}$ (4) $\frac{7}{4}$

Scan or tap for the full solution

Q.58 If $\frac{\tan(A-B)}{\tan A} + \frac{\sin^2 C}{\sin^2 A} = 1,\ A, B, C \in \left(0, \frac{\pi}{2}\right)$, then

[JEE Main 2026 (Online) 28th January Morning Shift]

(1) $\tan A, \tan C, \tan B$ are in A.P. (2) $\tan A, \tan C, \tan B$ are in G.P.

(3) $\tan A, \tan B, \tan C$ are in G.P. (4) $\tan A, \tan B, \tan C$ are in A.P.

Scan or tap for the full solution

Q.59 If the distances of the point (1, 2, a) from the line $\frac{x-1}{1} = \frac{y}{2} = \frac{z-1}{1}$ along the lines

$L_1 : \frac{x-1}{3} = \frac{y-2}{4} = \frac{z-a}{b}$ and $L_2 : \frac{x-1}{1} = \frac{y-2}{4} = \frac{z-a}{c}$

are equal, then a + b + c is equal to

[JEE Main 2026 (Online) 28th January Morning Shift]

(1) 4 (2) 6 (3) 7 (4) 5

Scan or tap for the full solution

Q.60 For three unit vectors $\vec{a}, \vec{b}, \vec{c}$ satisfying

$|\vec{a} - \vec{b}|^2 + |\vec{b} - \vec{c}|^2 + |\vec{c} - \vec{a}|^2 = 9$ and $|2\vec{a} + k\vec{b} + k\vec{c}| = 3$,

the positive value of k is :

[JEE Main 2026 (Online) 28th January Morning Shift]

(1) 4 (2) 5 (3) 6 (4) 3

Scan or tap for the full solution

Section B (Numerical) — 15 questions

Q.61 A solid sphere of radius 10 cm is rotating about an axis which is at a distance 15 cm from its centre. The radius of gyration about this axis is $\sqrt{n}$ cm. The value of n is

[JEE Main 2026 (Online) 28th January Morning Shift]

Scan or tap for the full solution

Q.62 The displacement of a particle, executing simple harmonic motion with time period T, is expressed as $x(t) = A\sin\omega t$, where A is the amplitude. The maximum value of potential energy of this oscillator is found at t = T/2β. The value of β is ____.

[JEE Main 2026 (Online) 28th January Morning Shift]

Scan or tap for the full solution

Q.63 The equivalent resistance between the points A and B in the following circuit is $\frac{x}{5}\ \Omega$. The value of x is ____. [JEE Main 2026 (Online) 28th January Morning Shift]

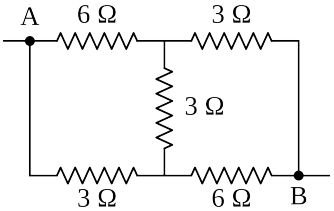

Scan or tap for the full solution

Q.64 A convex lens of refractive index 1.5 and focal length f = 18 cm is immersed in water. The difference in focal lengths of the given lens when it is in water and in air is α × f. The value of α is ____. (refractive index of water = 4/3)

[JEE Main 2026 (Online) 28th January Morning Shift]

Scan or tap for the full solution

Q.65 The ratio of de Broglie wavelength of a deuteron with kinetic energy E to that of an alpha particle with kinetic energy 2E, is n:1. The value of n is ____.

(Assume mass of proton = mass of neutron)

[JEE Main 2026 (Online) 28th January Morning Shift]

Scan or tap for the full solution

Q.66 Consider the following redox reaction taking place in acidic medium

$BH_4^-(aq) + ClO_3^-(aq) \longrightarrow H_2BO_3^-(aq) + Cl^-(aq)$

If the Nernst equation for the above balanced reaction is

$E_{cell} = E°_{cell} - \frac{RT}{nF}\ln Q$,

then the value of n is _____. (Nearest integer)

[JEE Main 2026 (Online) 28th January Morning Shift]

Scan or tap for the full solution

Q.67 X is the number of geometrical isomers exhibited by $[Pt(NH_3)(H_2O)BrCl]$.

Y is the number of optically inactive isomer(s) exhibited by $[CrCl_2(ox)_2]^{3-}$.

Z is the number of geometrical isomers exhibited by $[Co(NH_3)_3(NO_2)_3]$.

The value of X + Y + Z is _____.

[JEE Main 2026 (Online) 28th January Morning Shift]

Scan or tap for the full solution

Q.68 Consider the dissociation equilibrium of the following weak acid

$HA \rightleftharpoons H^+(aq) + A^-(aq)$

If the pK_a of the acid is 4, then the pH of 10 mM HA solution is _____. (Nearest integer)

[Given: The degree of dissociation can be neglected with respect to unity]

[JEE Main 2026 (Online) 28th January Morning Shift]

Scan or tap for the full solution

Q.69 0.53 g of an organic compound (x) when heated with excess of nitric acid (concentrated) and then with silver nitrate gave 0.75 g of silver bromide precipitate. 1.0 g of (x) gave 1.32 g of CO_2 gas on combustion. The percentage of hydrogen in the compound (x) is _____ %. [Nearest Integer]

[Given: Molar mass in g mol^{-1} H : 1, C : 12, Br : 80, Ag : 108, O : 16; Compound (x) : $C_xH_yBr_z$]

[JEE Main 2026 (Online) 28th January Morning Shift]

Scan or tap for the full solution

Q.70 500 mL of 1.2 M KI solution is mixed with 500 mL of 0.2 M $KMnO_4$ solution in basic medium. The liberated iodine was titrated with standard 0.1 M $Na_2S_2O_3$ solution in the presence of starch indicator till the blue color disappeared. The volume (in L) of $Na_2S_2O_3$ consumed is _____. (Nearest integer)

[JEE Main 2026 (Online) 28th January Morning Shift]

Scan or tap for the full solution

Q.71 For some $\theta \in \left(0, \frac{\pi}{2}\right)$, let the eccentricity and the length of the latus rectum of the hyperbola $x^2 - y^2\sec^2\theta = 8$ be e_1 and l_1, respectively, and let the eccentricity and the length of the latus rectum of the ellipse $x^2\sec^2\theta + y^2 = 6$ be e_2 and l_2, respectively. If $e_1^2 = e_2^2(\sec^2\theta + 1)$, then $\left(\frac{l_1 l_2}{e_1 e_2}\right)\tan^2\theta$ is equal to _____.

[JEE Main 2026 (Online) 28th January Morning Shift]

Scan or tap for the full solution

Q.72 In a G.P., if the product of the first three terms is 27 and the set of all possible values for the sum of its first three terms is $R - (a, b)$, then $a^2 + b^2$ is equal to _____.

[JEE Main 2026 (Online) 28th January Morning Shift]

Scan or tap for the full solution

Q.73 If $k = \tan\left(\frac{\pi}{4} + \frac{1}{2}\cos^{-1}\left(\frac{2}{3}\right)\right) + \tan\left(\frac{1}{2}\sin^{-1}\left(\frac{2}{3}\right)\right)$, then

the number of solutions of the equation $\sin^{-1}(kx - 1) = \sin^{-1}x - \cos^{-1}x$ is _____.

[JEE Main 2026 (Online) 28th January Morning Shift]

Scan or tap for the full solution

Q.74 The value of $\sum_{r=1}^{20}\left(\left|\sqrt{\pi\left(\int_0^r x|\sin \pi x|dx\right)}\right|\right)$ is _____.

[JEE Main 2026 (Online) 28th January Morning Shift]

Scan or tap for the full solution

Q.75 Let PQR be a triangle such that $\overrightarrow{PQ} = -2\hat{i} - \hat{j} + 2\hat{k}$ and $\overrightarrow{PR} = a\hat{i} + b\hat{j} - 4\hat{k}$, $a, b \in Z$. Let S be the point on QR, which is equidistant from the lines PQ and PR. If $|\overrightarrow{PR}| = 9$ and $\overrightarrow{PS}$ is parallel to $\hat{i} - 7\hat{j} + 2\hat{k}$, then the value of 3a − 4b is _____.

[JEE Main 2026 (Online) 28th January Morning Shift]

Scan or tap for the full solution

ANSWER KEY

Section A (MCQ) — 60 questions

Ques.	1	2	3	4	5	6	7	8	9	10	11
Ans.	**4**	**3**	**2**	**2**	**2**	**4**	**3**	**4**	**2**	**2**	**2**
Ques.	12	13	14	15	16	17	18	19	20	21	22
Ans.	**3**	**3**	**2**	**2**	**3**	**3**	**1**	**4**	**4**	**2**	**1**
Ques.	23	24	25	26	27	28	29	30	31	32	33
Ans.	**3**	**3**	**1**	**2**	**3**	**2**	**4**	**3**	**1**	**2**	**3**
Ques.	34	35	36	37	38	39	40	41	42	43	44
Ans.	**2**	**4**	**2**	**4**	**4**	**4**	**1**	**4**	**1**	**4**	**3**
Ques.	45	46	47	48	49	50	51	52	53	54	55
Ans.	**2**	**4**	**4**	**3**	**2**	**1**	**2**	**4**	**4**	**2**	**4**
Ques.	56	57	58	59	60						
Ans.	**2**	**4**	**2**	**3**	**2**						

Section B (Numerical) — 15 questions

Ques.	61	62	63	64	65	66	67
Ans.	**265**	**2**	**21**	**3**	**2**	**24**	**6**
Ques.	68	69	70	71	72	73	74
Ans.	**3**	**4**	**3**	**8**	**90**	**1**	**210**
Ques.	75						
Ans.	**37**						