PYQSide PYQSide.com — free PYQs with solutions Powered by TestBlink

JEE MAIN 2026 (ONLINE) 24TH JANUARY MORNING SHIFT

Question Paper · answer key at the end

Time: 3 Hours **Max. Marks:** 300 **Questions:** 75

General Instructions:

1. The duration of the paper is 3 hours. It has 75 questions: Physics 25, Chemistry 25, Mathematics 25.
2. Each subject has Section A (multiple-choice questions, only one correct answer) and Section B (numerical-value questions).
3. Marking: +4 for each correct answer, −1 for each wrong answer, 0 for a question not answered.
4. The answer key is at the end. Scan the QR code beside any question for its step-by-step solution.
5. Practise this paper as a timed test on the real exam screen, free, at pyqside.com.

Section A (MCQ) — 60 questions

Q.1 A cylindrical block of mass M and area of cross section A is floating in a liquid of density ρ and with its axis vertical. When depressed a little and released the block starts oscillating. The period of oscillation is _____

[JEE Main 2026 (Online) 24th January Morning Shift]

(1) $2\pi\sqrt{\frac{\rho A}{Mg}}$ (2) $\pi\sqrt{\frac{2M}{\rho Ag}}$

(3) $2\pi\sqrt{\frac{M}{\rho Ag}}$ (4) $\pi\sqrt{\frac{\rho A}{Mg}}$

Scan or tap for the full solution

Q.2 The electrostatic potential in a charged spherical region of radius r varies as $V = ar^3 + b$, where a and b are constants. The total charge in the sphere of unit radius is $\alpha \times \pi a \varepsilon_0$. The value of α is _____. (permittivity of vacuum is ε_0)

[JEE Main 2026 (Online) 24th January Morning Shift]

(1) −12 (2) −8 (3) −9 (4) −6

Scan or tap for the full solution

Q.3 The exit surface of a prism with refractive index n is coated with a material having refractive index $\frac{n}{2}$. When this prism is set for minimum angle of deviation, it exactly meets the condition of critical angle. The prism angle is _____.

[JEE Main 2026 (Online) 24th January Morning Shift]

(1) 60° (2) 30° (3) 15° (4) 45°

Scan or tap for the full solution

Q.4 A brass wire of length 2 m and radius 1 mm at 27°C is held taut between two rigid supports. Initially it was cooled to a temperature of −43°C creating a tension T in the wire. The temperature to which the wire has to be cooled in order to increase the tension in it to 1.4T, is _____ °C.

[JEE Main 2026 (Online) 24th January Morning Shift]

(1) −71 (2) −80 (3) −65 (4) −86

Scan or tap for the full solution

Q.5 A spring of force constant 15 N/m is cut into two pieces. If the ratio of their lengths is 1:3, then the force constant of smaller piece is _____ N/m.

[JEE Main 2026 (Online) 24th January Morning Shift]

(1) 20 (2) 45 (3) 60 (4) 15

Scan or tap for the full solution

Q.6 Match the **LIST-I** with **LIST-II**

List-I		List-II	
A.	Radio-wave	I.	is produced by Magnetron valve
B.	Micro-wave	II.	due to change in the vibrational modes of atoms
C.	Infrared-wave	III.	due to inner shell electrons moving from higher energy level to lower energy level
D.	X-ray	IV.	due to rapid acceleration of electrons

Choose the correct answer from the options given below:

[JEE Main 2026 (Online) 24th January Morning Shift]

(1) A-IV, B-II, C-I, D-III (2) A-IV, B-III, C-I, D-II
(3) A-IV, B-I, C-II, D-III (4) A-II, B-IV, C-III, D-I

Scan or tap for the full solution

Q.7 Two resistors of 100 Ω each are connected in series with a 9 V battery. A voltmeter of 400 Ω resistance is connected to measure the voltage drop across one of the resistors. The voltmeter reading is _____ V.

[JEE Main 2026 (Online) 24th January Morning Shift]

(1) 3 (2) 2 (3) 4 (4) 4.5

Scan or tap for the full solution

Q.8 An unpolarised light is incident at an interface of two dielectric media having refractive indices of 2 (incident medium) and $2\sqrt{3}$ (refracted medium) respectively. To satisfy the condition that reflected and refracted rays are perpendicular to each other, the angle of incidence is _____

[JEE Main 2026 (Online) 24th January Morning Shift]

(1) 45° (2) 60° (3) 10° (4) 30°

Scan or tap for the full solution

Q.9 Two electrons are moving in orbits of two hydrogen-like atoms with speeds 3×10^5 m/s and 2.5×10^5 m/s respectively. If the radii of these orbits are nearly same then the possible order of energy states are _____ respectively.

[JEE Main 2026 (Online) 24th January Morning Shift]

(1) 8 and 10 (2) 10 and 12
(3) 9 and 8 (4) 6 and 5

Scan or tap for the full solution

Q.10 In a microscope of tube length 10 cm two convex lenses are arranged with focal lengths of 2 cm and 5 cm. Total magnification obtained with this system for normal adjustment is $(5)^k$. The value of k is _____.

[JEE Main 2026 (Online) 24th January Morning Shift]

(1) 4 (2) 5 (3) 2 (4) 3.5

Scan or tap for the full solution

Q.11 Given below are two statements :

Statement-I: For all elements, greater the mass of the nucleus, greater is the binding energy per nucleon.

Statement-II: For all elements, nuclei with less binding energy per nucleon transform to nuclei with greater binding energy per nucleon.

In the light of the above statements, choose the correct answer from the options given below

[JEE Main 2026 (Online) 24th January Morning Shift]

(1) Statement-I is false but Statement-II is true
(2) Both Statement-I and Statement-II are true
(3) Both Statement-I and Statement-II are false
(4) Statement-I is true but Statement-II is false

Scan or tap for the full solution

Q.12 For the series LCR circuit connected with 220 V, 50 Hz a.c. source as shown in the figure, the power factor is $\frac{\alpha}{10}$. The value of α is _____.

[JEE Main 2026 (Online) 24th January Morning Shift]

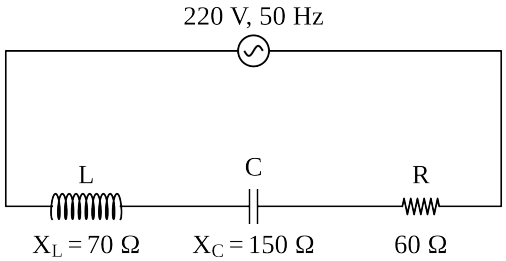

(1) 4 (2) 8 (3) 6 (4) 10

Scan or tap for the full solution

Q.13 Two masses 400 g and 350 g are suspended from the ends of a light string passing over a heavy pulley of radius 2 cm. When released from rest the heavier mass is observed to fall 81 cm in 9 s. The rotational inertia of the pulley is _____ kg·m^2. (g = 9.8 m/s^2)

[JEE Main 2026 (Online) 24th January Morning Shift]

(1) 8.3×10^{-3} (2) 4.75×10^{-3}
(3) 1.86×10^{-2} (4) 9.5×10^{-3}

Scan or tap for the full solution

Q.14 Three masses 200 kg, 300 kg and 400 kg are placed at the vertices of an equilateral triangle with sides 20 m. They are rearranged on the vertices of a bigger triangle of side 25 m and with the same centre. The work done in this process is _____ J. (Gravitational constant $G = 6.7 \times 10^{-11}$ N m^2/kg^2)

[JEE Main 2026 (Online) 24th January Morning Shift]

(1) 4.77×10^{-7} (2) 1.74×10^{-7}
(3) 9.86×10^{-6} (4) 2.85×10^{-7}

Scan or tap for the full solution

Q.15 Two resistors 2 Ω and 3 Ω are connected in the gaps of bridge as shown in figure. The null point is obtained with the contact of jockey at some point on wire XY. When an unknown resistor is connected in parallel with 3 Ω resistor, the null point is shifted by 22.5 cm toward Y. The resistance of unknown resistor is _____ Ω.

[JEE Main 2026 (Online) 24th January Morning Shift]

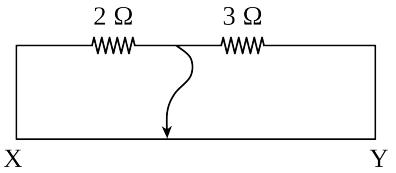

(1) 3 (2) 1 (3) 4 (4) 2

Scan or tap for the full solution

Q.16 There are three concentric conducting spherical shells A, B and C of radii a, b and c respectively (c > b > a) and they are charged with charges q_1, q_2 and q_3 respectively. The potentials of the spheres A, B and C respectively, are :

[JEE Main 2026 (Online) 24th January Morning Shift]

(1) $\frac{1}{4\pi\varepsilon_0}\left(\frac{q_1}{a}+\frac{q_2}{b}+\frac{q_3}{c}\right), \frac{1}{4\pi\varepsilon_0}\left(\frac{q_1+q_2+q_3}{b}\right), \frac{1}{4\pi\varepsilon_0}\left(\frac{q_1+q_2+q_3}{c}\right)$

(2) $\frac{1}{4\pi\varepsilon_0}\left(\frac{q_1+q_2+q_3}{a}\right), \frac{1}{4\pi\varepsilon_0}\left(\frac{q_1+q_2+q_3}{b}\right), \frac{1}{4\pi\varepsilon_0}\left(\frac{q_1+q_2+q_3}{c}\right)$

(3) $\frac{1}{4\pi\varepsilon_0}\left(\frac{q_1+q_2+q_3}{a}\right), \frac{1}{4\pi\varepsilon_0}\left(\frac{q_1+q_2}{b}+\frac{q_3}{c}\right), \frac{1}{4\pi\varepsilon_0}\left(\frac{q_1}{a}+\frac{q_2}{b}+\frac{q_3}{c}\right)$

(4) $\frac{1}{4\pi\varepsilon_0}\left(\frac{q_1}{a}+\frac{q_2}{b}+\frac{q_3}{c}\right), \frac{1}{4\pi\varepsilon_0}\left(\frac{q_1+q_2}{b}+\frac{q_3}{c}\right), \frac{1}{4\pi\varepsilon_0}\left(\frac{q_1+q_2+q_3}{c}\right)$

Scan or tap for the full solution

Q.17 Three charges +2q, + 3q and −4q are situated at (0, − 3a), (2a, 0) and (−2a, 0) respectively in the xy plane. The resultant dipole moment about origin is _____.

[JEE Main 2026 (Online) 24th January Morning Shift]

(1) $2qa(7\hat{i}-3\hat{j})$ (2) $2qa(3\hat{j}-7\hat{i})$

(3) $2qa(3\hat{i}-7\hat{j})$ (4) $2qa(3\hat{j}-\hat{i})$

Scan or tap for the full solution

Q.18 A boy throws a ball into air at 45° from the horizontal to land it on a roof of a building of height H. If the ball attains maximum height in 2 s and lands on the building in 3 s after launch, then value of H is _____ m.
($g = 10\ m/s^2$)

[JEE Main 2026 (Online) 24th January Morning Shift]

(1) 20 (2) 25 (3) 10 (4) 15

Scan or tap for the full solution

Q.19 Densities of water at 4°C and 20°C are 1000 kg/m^3 and 998 kg/m^3 respectively. The increase in internal energy of 4 kg of water when it is heated from 4°C to 20°C is _____ J.
(specific heat capacity of water = 4.2 kJ/kg K and 1 atmospheric pressure = 10^5 Pa)

[JEE Main 2026 (Online) 24th January Morning Shift]

(1) 268799.2 (2) 315826.2

(3) 234699.2 (4) 258700.8

Scan or tap for the full solution

Q.20 Match the **LIST-I** with **LIST-II**

	List-I		List-II
A.	Magnetic induction	I.	$MLT^{-2}A^{-2}$
B.	Magnetic flux	II.	$ML^2T^{-2}A^{-2}$
C.	Magnetic permeability	III.	$ML^0T^{-2}A^{-1}$
D.	Self inductance	IV.	$ML^2T^{-2}A^{-1}$

Choose the correct answer from the options given below:

[JEE Main 2026 (Online) 24th January Morning Shift]

(1) A-III, B-IV, C-II, D-I (2) A-I, B-III, C-IV, D-II

(3) A-IV, B-III, C-I, D-II (4) A-III, B-IV, C-I, D-II

Scan or tap for the full solution

Q.21 Given below are two statements :

Statement-I: 'C–Cl' bond is stronger in CH_2=CH–Cl than CH_3–CH_2–Cl

Statement-II: The given optically active molecule,

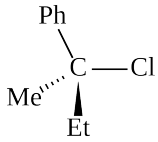

on hydrolysis gives a solution that can rotate the plane polarized light.

In the light of the above statements, choose the correct answer from the options given below

[JEE Main 2026 (Online) 24th January Morning Shift]

(1) Statement-I is false but Statement-II is true

(2) Statement-I is true but Statement-II is false

(3) Both Statement-I and Statement-II are true

(4) Both Statement-I and Statement-II are false

Scan or tap for the full solution

Q.22 Match the **LIST-I** with **LIST-II**

	List-I Isothermal process for ideal gas system		List-II Work done ($V_f > V_i$)
A.	Reversible expansion	I.	$w = 0$
B.	Free expansion	II.	$w = -nRT\ln\left(\frac{V_f}{V_i}\right)$
C.	Irreversible expansion	III.	$w = -p_{ex}(V_f - V_i)$
D.	Irreversible compression	IV.	$w = -p_{ex}(V_i - V_f)$

Choose the correct answer from the options given below:

[JEE Main 2026 (Online) 24th January Morning Shift]

(1) A-IV, B-I, C-III, D-II (2) A-I, B-III, C-II, D-IV

(3) A-II, B-I, C-III, D-IV (4) A-IV, B-II, C-III, D-I

Scan or tap for the full solution

Q.23 Given below are statements about some molecules/ions.

A. The dipole moment value of NF_3 is higher than that of NH_3.

B. The dipole moment value of BeH_2 is zero.

C. The bond order of O_2^{2-} and F_2 is same.

D. The formal charge on the central oxygen atom of ozone is −1.

E. In NO_2, all the three atoms satisfy the octet rule, hence it is very stable.

Identify the CORRECT statements.

Choose the correct answer from the options given below:

[JEE Main 2026 (Online) 24th January Morning Shift]

(1) B & C Only (2) B, C & D Only

(3) A, C & D Only (4) A, B, C, D & E

Scan or tap for the full solution

Q.24 Arrange the following alkenes in decreasing order of stability.

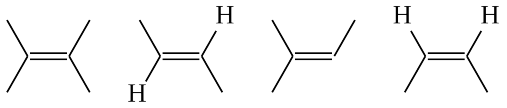

I II III IV

Choose the correct answer from the options given below:

[JEE Main 2026 (Online) 24th January Morning Shift]

(1) III > I > II > IV (2) III > II > I > IV

(3) I > III > II > IV (4) I > III > IV > II

Scan or tap for the full solution

Q.25 Given below are two statements :

Statement-I: Hybridisation, shape and spin only magnetic moment of $K_3[Co(CO_3)_3]$ is sp^3d^2, octahedral and 4.9 BM respectively.

Statement-II: Geometry, hybridisation and spin only magnetic moment values (BM) of the ions $[Ni(CN)_4]^{2-}$, $[MnBr_4]^{2-}$ and $[CoF_6]^{3-}$ respectively are square planar, tetrahedral, octahedral; dsp^2, sp^3, sp^3d^2 and 0, 5.9, 4.9.

In the light of the above statements, choose the correct answer from the options given below

[JEE Main 2026 (Online) 24th January Morning Shift]

(1) Both Statement-I and Statement-II are false

(2) Statement-I is true but Statement-II is false

(3) Both Statement-I and Statement-II are true

(4) Statement-I is false but Statement-II is true

Scan or tap for the full solution

Q.26 A solution is prepared by dissolving 0.3 g of a non-volatile non-electrolyte solute 'A' of molar mass 60 g mol^{-1} and 0.9 g of a non-volatile non-electrolyte solute 'B' of molar mass 180 g mol^{-1} in 100 mL H_2O at 27°C. Osmotic pressure of the solution will be

[Given: R = 0.082 L atm K^{-1} mol^{-1}]

[JEE Main 2026 (Online) 24th January Morning Shift]

(1) 2.46 atm (2) 0.82 atm

(3) 1.47 atm (4) 1.23 atm

Scan or tap for the full solution

Q.27 Given below are two statements:

Statement-I: The number of paramagnetic species among $[CoF_6]^{3-}$, $[TiF_6]^{3-}$, V_2O_5 and $[Fe(CN)_6]^{3-}$ is 3.

Statement-II: $K_4[Fe(CN)_6]$ < $K_3[Fe(CN)_6]$ < $[Fe(H_2O)_6]SO_4 \cdot H_2O$ < $[Fe(H_2O)_6]Cl_3$ is the correct order in terms of number of unpaired electron(s) present in the complexes.

In the light of the above statements, choose the correct answer from the options given below

[JEE Main 2026 (Online) 24th January Morning Shift]

(1) Statement-I is true but Statement-II is false

(2) Both Statement-I and Statement-II are false

(3) Statement-I is false but Statement-II is true

(4) Both Statement-I and Statement-II are true

Scan or tap for the full solution

Q.28 Given below are two statements :

Statement-I: K > Mg > Al > B is the correct order in terms of metallic character.

Statement-II: Atomic radius is always greater than the ionic radius for any element.

In the light of the above statements, choose the correct answer from the options given below

[JEE Main 2026 (Online) 24th January Morning Shift]

(1) Both Statement-I and Statement-II are false

(2) Statement-I is false but Statement-II is true

(3) Statement-I is true but Statement-II is false

(4) Both Statement-I and Statement-II are true

Scan or tap for the full solution

Q.29 Among the following, the CORRECT combinations are

A. $IF_3 \longrightarrow$ T-shaped (sp^3d)

B. $IF_5 \longrightarrow$ Square pyramidal (sp^3d^2)
C. $IF_7 \longrightarrow$ Pentagonal bipyramidal (sp^3d^3)
D. $ClO_4^- \longrightarrow$ Square planar (sp^2d)

Choose the correct answer from the options given below:

[JEE Main 2026 (Online) 24th January Morning Shift]

(1) B, C and D Only (2) A, B, C and D
(3) A, B and C Only (4) A and B Only

Scan or tap for the full solution

Q.30 $A \longrightarrow D$ is an endothermic reaction occurring in three steps (elementary).

(i) $A \longrightarrow B$, $\Delta H_i = +$ ve
(ii) $B \longrightarrow C$, $\Delta H_{ii} = -$ve
(iii) $C \longrightarrow D$, $\Delta H_{iii} = -$ve

Which of the following graphs between potential energy (y-axis) vs reaction coordinate (x-axis) correctly represents the reaction profile of $A \longrightarrow D$?

[JEE Main 2026 (Online) 24th January Morning Shift]

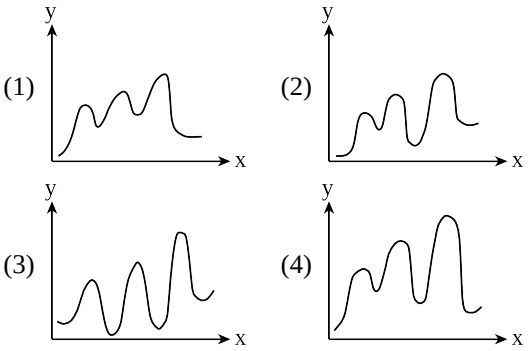

Scan or tap for the full solution

Q.31 Consider a mixture 'X' which is made by dissolving 0.4 mol of $[Co(NH_3)_5SO_4]Br$ and 0.4 mol of $[Co(NH_3)_5Br]SO_4$ in water to make 4 L of solution. When 2 L of mixture 'X' is allowed to react with excess of $AgNO_3$, it forms precipitate 'Y'. The rest 2 L of mixture 'X' reacts with excess $BaCl_2$ to form precipitate 'Z'. Which of the following statements is CORRECT?

[JEE Main 2026 (Online) 24th January Morning Shift]

(1) 0.1 mol of 'Y' is formed.
(2) 0.4 mol of 'Z' is formed.
(3) 0.2 mol of 'Z' is formed.
(4) 'Y' is $BaSO_4$ and 'Z' is AgBr.

Scan or tap for the full solution

Q.32 Consider the following two reactions A and B.

(A) 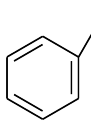 $\xrightarrow{Na}$ Main Product + gas (x)

(B) 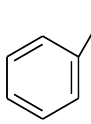 $\xrightarrow{NaHCO_3}$ Main Product + gas (y)

Numerical value of [molar mass of x + molar mass of y] is _____

[JEE Main 2026 (Online) 24th January Morning Shift]

(1) 46 (2) 160 (3) 88 (4) 4

Scan or tap for the full solution

Q.33 Arrange the following carbanions in the decreasing order of stability.

I. $p\text{–}Br\text{–}C_6H_4\text{–}\ddot{C}H_2^{\ominus}$

II. $C_6H_5\text{–}\ddot{C}H_2^{\ominus}$

III. $p\text{–}CH_3O\text{–}C_6H_4\text{–}\ddot{C}H_2^{\ominus}$

IV. $p\text{–}CHO\text{–}C_6H_4\text{–}\ddot{C}H_2^{\ominus}$

V. $p\text{–}CH_3\text{–}C_6H_4\text{–}\ddot{C}H_2^{\ominus}$

Choose the correct answer from the options given below :

[JEE Main 2026 (Online) 24th January Morning Shift]

(1) I > II > IV > V > III (2) IV > II > I > III > V
(3) I > IV > II > V > III (4) IV > I > II > V > III

Scan or tap for the full solution

Q.34 At 27°C in presence of a catalyst, activation energy of a reaction is lowered by 10 kJ mol^{-1}. The logarithm of ratio of $\frac{k\ (catalysed)}{k\ (uncatalysed)}$ is....

(Consider that the frequency factor for both the reactions is same)

[JEE Main 2026 (Online) 24th January Morning Shift]

(1) 1.741 (2) 0.1741 (3) 17.41 (4) 3.482

Scan or tap for the full solution

Q.35 A student is given one compound among the following compounds that gives positive test with Tollens' reagent.

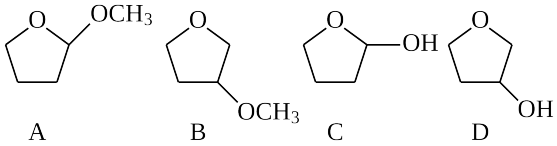

The compound is :

[JEE Main 2026 (Online) 24th January Morning Shift]

(1) B (2) D (3) A (4) C

Scan or tap for the full solution

Q.36 Consider three metal chlorides x, y and z, where x is water soluble at room temperature, y is sparingly soluble in water at room temperature and z is soluble in hot water. x, y and z are respectively

[JEE Main 2026 (Online) 24th January Morning Shift]

(1) AgCl, Hg_2Cl_2 and $PbCl_2$

(2) $CuCl_2$, AgCl and $PbCl_2$

(3) $AlCl_3$, $PbCl_2$ and $BaCl_2$

(4) $MgCl_2$, AgCl and $AlCl_3$

Scan or tap for the full solution

Q.37 Match the **List-I** with **List-II**

List-I Chloro derivative	
A.	Vinyl Chloride
B.	Benzyl Chloride
C.	Alkyl Chloride
D.	Allyl Chloride

List-II Example	
I.	$CH_2{=}CH{-}CH_2Cl$
II.	$CH_3{-}CH(Cl)CH_3$
III.	$CH_2{=}CHCl$
IV.	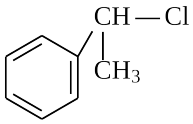

Choose the **correct** answer from the options given below :

[JEE Main 2026 (Online) 24th January Morning Shift]

(1) A-III, B-IV, C-I, D-II (2) A-IV, B-I, C-III, D-II

(3) A-III, B-IV, C-II, D-I (4) A-I, B-II, C-IV, D-III

Scan or tap for the full solution

Q.38 The correct stability order of the following diazonium salts is

[JEE Main 2026 (Online) 24th January Morning Shift]

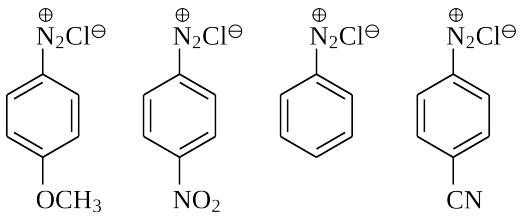

A B C D

(1) C > D > B > A (2) A > C > D > B

(3) A > B > C > D (4) C > A > D > B

Scan or tap for the full solution

Q.39 A hydroxy compound (X) with molar mass 122 g mol^{-1} is acetylated with acetic anhydride, using a large excess of the reagent ensuring complete acetylation of all hydroxyl groups. The product obtained has a molar mass of 290 g mol^{-1}. The number of hydroxyl groups present in compound (X) is:

[JEE Main 2026 (Online) 24th January Morning Shift]

(1) 2 (2) 4 (3) 3 (4) 5

Scan or tap for the full solution

Q.40 'W' g of a non-volatile electrolyte solid solute of molar mass 'M' g mol^{-1} when dissolved in 100 mL water, decreases vapour pressure of water from 640 mm Hg to 600 mm Hg. If aqueous solution of the electrolyte boils at 375 K and K_b for water is 0.52 K kg mol^{-1}, then the mole fraction of the electrolyte solute (x_2) in the solution can be expressed as

(Given : density of water = 1 g/mL and boiling point of water = 373 K)

[JEE Main 2026 (Online) 24th January Morning Shift]

(1) $\frac{16}{2.6}\times\frac{W}{M}$ (2) $\frac{1.3}{8}\times\frac{M}{W}$

(3) $\frac{2.6}{16}\times\frac{M}{W}$ (4) $\frac{1.3}{8}\times\frac{W}{M}$

Scan or tap for the full solution

Q.41 Let $\vec{a}=2\hat{i}+\hat{j}-2\hat{k}$, $\vec{b}=\hat{i}+\hat{j}$ and $\vec{c}=\vec{a}\times\vec{b}$. Let $\vec{d}$ be a vector such that $|\vec{d}-\vec{a}|=\sqrt{11}$, $|\vec{c}\times\vec{d}|=3$ and the angle between $\vec{c}$ and $\vec{d}$ is $\frac{\pi}{4}$. Then $\vec{a}\cdot\vec{d}$ is equal to

[JEE Main 2026 (Online) 24th January Morning Shift]

(1) 0 (2) 1 (3) 3 (4) 11

Scan or tap for the full solution

Q.42 Let A(1, 0), B(2, − 1) and $C\left(\frac{7}{3}, \frac{4}{3}\right)$ be three points. If the equation of the bisector of the angle ABC is $\alpha x + \beta y = 5$, then the value of $\alpha^2 + \beta^2$ is

[JEE Main 2026 (Online) 24th January Morning Shift]

(1) 5 (2) 10 (3) 8 (4) 13

Scan or tap for the full solution

Q.43 Let A_1 be the bounded area enclosed by the curves $y = x^2 + 2$, $x + y = 8$ and y-axis that lies in the first quadrant. Let A_2 be the bounded area enclosed by the curves $y = x^2 + 2$, $y^2 = x$, $x = 2$, and y-axis that lies in the first quadrant. Then $A_1 - A_2$ is equal to

[JEE Main 2026 (Online) 24th January Morning Shift]

(1) $\frac{2}{3}(2\sqrt{2}+1)$ (2) $\frac{2}{3}(3\sqrt{2}+1)$

(3) $\frac{2}{3}(\sqrt{2}+1)$ (4) $\frac{2}{3}(4\sqrt{2}+1)$

Scan or tap for the full solution

Q.44 Let a circle of radius 4 pass through the origin O, the points $A(-\sqrt{3}a, 0)$ and $B(0, -\sqrt{2}b)$, where a and b are real parameters and $ab \neq 0$. Then the locus of the centroid of $\triangle OAB$ is a circle of radius

[JEE Main 2026 (Online) 24th January Morning Shift]

(1) $\frac{7}{3}$ (2) $\frac{11}{3}$ (3) $\frac{5}{3}$ (4) $\frac{8}{3}$

Scan or tap for the full solution

Q.45 The number of the real solutions of the equation: $x|x+3| + |x-1| - 2 = 0$ is

[JEE Main 2026 (Online) 24th January Morning Shift]

(1) 3 (2) 2 (3) 5 (4) 4

Scan or tap for the full solution

Q.46 The value of $\frac{\sqrt{3}\operatorname{cosec}20^\circ - \sec 20^\circ}{\cos 20^\circ \cos 40^\circ \cos 60^\circ \cos 80^\circ}$ is equal to [JEE Main 2026 (Online) 24th January Morning Shift]

(1) 32 (2) 64 (3) 12 (4) 16

Scan or tap for the full solution

Q.47 If the domain of the function

$f(x) = \log_{(10x^2-17x+7)}(18x^2 - 11x + 1)$

is $(-\infty, a) \cup (b, c) \cup (d, \infty) - \{e\}$, then

$90(a + b + c + d + e)$ equals:

[JEE Main 2026 (Online) 24th January Morning Shift]

(1) 170 (2) 316 (3) 177 (4) 307

Scan or tap for the full solution

Q.48 If $\cot x = \frac{5}{12}$ for some $x \in \left(\pi, \frac{3\pi}{2}\right)$, then

$\sin 7x\left(\cos\frac{13x}{2} + \sin\frac{13x}{2}\right) + \cos 7x\left(\cos\frac{13x}{2} - \sin\frac{13x}{2}\right)$

is equal to

[JEE Main 2026 (Online) 24th January Morning Shift]

(1) $\frac{5}{\sqrt{13}}$ (2) $\frac{6}{\sqrt{26}}$ (3) $\frac{4}{\sqrt{26}}$ (4) $\frac{1}{\sqrt{13}}$

Scan or tap for the full solution

Q.49 Let $\alpha, \beta \in R$ be such that the function

f(x) = begincases 2alphaleft(x2 - 2right) + 2beta x, & x <

1 (alpha + 3)mathrmx + (alpha - beta), & mathrmx ≥ 1 endmathrmcases be differentiable at all $x \in R$.

Then $34(\alpha + \beta)$ is equal to

[JEE Main 2026 (Online) 24th January Morning Shift]

(1) 48 (2) 84 (3) 36 (4) 24

Scan or tap for the full solution

Q.50 Let $f(t) = \int\left(\frac{1-\sin(\log_e t)}{1-\cos(\log_e t)}\right)dt,\ t > 1.$

If $f(e^{\pi/2}) = -e^{\pi/2}$ and $f(e^{\pi/4}) = \alpha e^{\pi/4}$, then α equals

[JEE Main 2026 (Online) 24th January Morning Shift]

(1) $1+\sqrt{2}$ (2) $-1-2\sqrt{2}$

(3) $-1-\sqrt{2}$ (4) $-1+\sqrt{2}$

Scan or tap for the full solution

Q.51 Let R be a relation defined on the set $\{1, 2, 3, 4\} \times \{1, 2, 3, 4\}$ by

$R = \{((a, b), (c, d)) : 2a + 3b = 3c + 4d\}$.

Then the number of elements in R is

[JEE Main 2026 (Online) 24th January Morning Shift]

(1) 6 (2) 15 (3) 12 (4) 18

Scan or tap for the full solution

Q.52 From a lot containing 10 defective and 90 non-defective bulbs, 8 bulbs are selected one by one with replacement. Then the probability of getting at least 7 defective bulbs is

[JEE Main 2026 (Online) 24th January Morning Shift]

(1) $\frac{73}{10^8}$ (2) $\frac{67}{10^8}$ (3) $\frac{7}{10^7}$ (4) $\frac{81}{10^8}$

Scan or tap for the full solution

Q.53 Let $S = \frac{1}{25!} + \frac{1}{3!\,23!} + \frac{1}{5!\,21!} + \ldots$ up to 13 terms. If $13S = \frac{2^k}{n!}$, $k \in N$, then $n + k$ is equal to

[JEE Main 2026 (Online) 24th January Morning Shift]

(1) 50 (2) 52 (3) 49 (4) 51

Scan or tap for the full solution

Q.54 Let 729, 81, 9, 1, … be a sequence and P_n denote the product of the first n terms of this sequence. If $2\sum_{n=1}^{40}(P_n)^{\frac{1}{n}} = \frac{3^\alpha - 1}{3^\beta}$ and $\gcd(\alpha, \beta) = 1$, then $\alpha + \beta$ is equal to

[JEE Main 2026 (Online) 24th January Morning Shift]

(1) 73 (2) 74 (3) 75 (4) 76

Scan or tap for the full solution

Q.55 Let the lines

$L_1 : \vec{r} = \hat{i} + 2\hat{j} + 3\hat{k} + \lambda(2\hat{i} + 3\hat{j} + 4\hat{k}),\ \lambda \in \mathbb{R}$ and

$L_2 : \vec{r} = (4\hat{i} + \hat{j}) + \mu(5\hat{i} + 2\hat{j} + \hat{k}),\ \mu \in \mathbb{R}$, intersect at the point R. Let P and Q be the points lying on lines L_1 and L_2, respectively, such that $|\vec{PR}| = \sqrt{29}$ and $|\vec{PQ}| = \sqrt{\frac{47}{3}}$. If the point P lies in the first octant, then $27(QR)^2$ is equal to

[JEE Main 2026 (Online) 24th January Morning Shift]

(1) 360 (2) 348 (3) 320 (4) 340

Scan or tap for the full solution

Q.56 Let $S = \left\{ z \in C : \left| \frac{z - 6i}{z - 2i} \right| = 1 \text{ and } \left| \frac{z - 8 + 2i}{z + 2i} \right| = \frac{3}{5} \right\}$.

Then $\sum_{z \in S} |z|^2$ is equal to :

[JEE Main 2026 (Online) 24th January Morning Shift]

(1) 413 (2) 398 (3) 385 (4) 423

Scan or tap for the full solution

Q.57 Consider an A.P.: $a_1, a_2, \ldots, a_n$; $a_1 > 0$. If $a_2 - a_1 = \frac{-3}{4}$, $a_n = \frac{1}{4}a_1$, and $\sum_{i=1}^{n} a_i = \frac{525}{2}$, then $\sum_{i=1}^{17} a_i$ is equal to

[JEE Main 2026 (Online) 24th January Morning Shift]

(1) 238 (2) 136 (3) 476 (4) 952

Scan or tap for the full solution

Q.58 The mean and variance of a data of 10 observations are 10 and 2, respectively. If an observation α in this data is replaced by β, then the mean and variance become 10.1 and 1.99, respectively. Then α + β equals

[JEE Main 2026 (Online) 24th January Morning Shift]

(1) 15 (2) 10 (3) 5 (4) 20

Scan or tap for the full solution

Q.59 Let each of the two ellipses $E_1 : \frac{x^2}{a^2} + \frac{y^2}{b^2} = 1,\ (a > b)$ and $E_2 : \frac{x^2}{A^2} + \frac{y^2}{B^2} = 1,\ (A < B)$ have eccentricity $\frac{4}{5}$. Let the lengths of the latus recta of E_1 and E_2 be l_1 and l_2, respectively, such that $2l_1^2 = 9l_2$. If the distance between the foci of E_1 is 8, then the distance between the foci of E_2 is

[JEE Main 2026 (Online) 24th January Morning Shift]

(1) $\frac{96}{5}$ (2) $\frac{8}{5}$ (3) $\frac{16}{5}$ (4) $\frac{32}{5}$

Scan or tap for the full solution

Q.60 If the function

$$f(x) = \frac{e^x(e^{\tan x - x} - 1) + \log_e(\sec x + \tan x) - x}{\tan x - x}$$ is

continuous at x = 0, then the value of f(0) is equal to

[JEE Main 2026 (Online) 24th January Morning Shift]

(1) $\frac{2}{3}$ (2) $\frac{1}{2}$ (3) 2 (4) $\frac{3}{2}$

Scan or tap for the full solution

Section B (Numerical) — 15 questions

Q.61 In the given figure the blocks A, B and C weigh 4 kg, 6 kg and 8 kg respectively. The coefficient of sliding friction between any two surfaces is 0.5. The force $\vec{F}$ required to slide the block C with constant speed is _____ N. (Use g = 10 m/s^2)

[JEE Main 2026 (Online) 24th January Morning Shift]

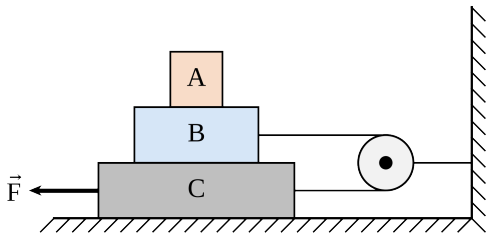

Scan or tap for the full solution

Q.62 A short bar magnet placed with its axis at 30° with an external field of 800 Gauss, experiences a torque of 0.016 N m. The work done in moving it from most stable to most unstable position is α × 10^{-3} J. The value of α is _____.

[JEE Main 2026 (Online) 24th January Morning Shift]

Scan or tap for the full solution

Q.63 A voltage regulating circuit consisting of Zener diode, having breakdown voltage of 10 V and maximum power dissipation of 0.4 W, is operated at 15 V. The approximate value of protective resistance in this circuit is _____ Ω.

[JEE Main 2026 (Online) 24th January Morning Shift]

Scan or tap for the full solution

Q.64 Sixty four raindrops of radius 1 mm each falling down with a terminal velocity of 10 cm/s coalesce to form a bigger drop. The terminal velocity of bigger drop is _____ cm/s.

[JEE Main 2026 (Online) 24th January Morning Shift]

Scan or tap for the full solution

Q.65 A gas of certain mass filled in a closed cylinder at a pressure of 3.23 kPa has temperature 50°C. The gas is now heated to double its temperature. The modified pressure is _____ Pa.

[JEE Main 2026 (Online) 24th January Morning Shift]

Scan or tap for the full solution

Q.66 The hydrogen spectrum consists of several spectral lines in Lyman series (L_1, L_2, L_3…;L_1 has lowest energy among Lyman series). Similarly it consists of several spectral lines in Balmer series (B_1, B_2, B_3…;B_1 has lowest energy among Balmer lines). The energy of L_1 is x times the energy of B_1. The value of x is _____ $\times 10^{-1}$. (Nearest integer)

[JEE Main 2026 (Online) 24th January Morning Shift]

Scan or tap for the full solution

Q.67 Electricity is passed through an acidic solution of Cu^{2+} till all the Cu^{2+} was exhausted, leading to the deposition of 300 mg of Cu metal. However, a current of 600 mA was continued to pass through the same solution for another 28 minutes by keeping the total volume of the solution fixed at 200 mL. The total volume of oxygen evolved at STP during the entire process is _____ mL. (Nearest integer)

[Given:

$Cu^{2+}(aq) + 2e^- \longrightarrow Cu(s)$; $E^\circ_{red} = +0.34$ V

$O_2(g) + 4H^+ + 4e^- \longrightarrow 2H_2O$; $E^\circ_{red} = +1.23$ V

Molar mass of Cu = 63.54 g mol^{-1}

Molar mass of O_2 = 32 g mol^{-1}

Faraday Constant = 96500 C mol^{-1}

Molar volume at STP = 22.4 L]

[JEE Main 2026 (Online) 24th January Morning Shift]

Scan or tap for the full solution

Q.68 Consider two Group IV metal ions X^{2+} and Y^{2+}.
A solution containing 0.01 M X^{2+} and 0.01 M Y^{2+} is saturated with H_2S. The pH at which the metal sulphide YS will form as a precipitate is _____. (Nearest integer)
(Given: $K_{sp}(XS) = 1 \times 10^{-22}$ at 25°C, $K_{sp}(YS) = 4 \times 10^{-16}$ at 25°C, $[H_2S] = 0.1$ M in solution, $K_{a1} \times K_{a2}(H_2S) = 1.0 \times 10^{-21}$, $\log 2 = 0.30$, $\log 3 = 0.48$, $\log 5 = 0.70$)

[JEE Main 2026 (Online) 24th January Morning Shift]

Scan or tap for the full solution

Q.69 In Dumas method for estimation of nitrogen, 0.50 g of an organic compound gave 70 mL of nitrogen collected at 300 K and 715 mm pressure. The percentage of nitrogen in the organic compound is _____ %.
(Aqueous tension at 300 K is 15 mm).

[JEE Main 2026 (Online) 24th January Morning Shift]

Scan or tap for the full solution

Q.70 X and Y are the number of electrons involved, respectively during the oxidation of I^- to I_2 and S^{2-} to S by acidified $K_2Cr_2O_7$. The value of X + Y is _____.

[JEE Main 2026 (Online) 24th January Morning Shift]

Scan or tap for the full solution

Q.71 Let (2α, α) be the largest interval in which the function $f(t) = \frac{|t+1|}{t^2}$, $t < 0$, is strictly decreasing. Then the local maximum value of the function $g(x) = 2\log_e(x-2) + \alpha x^2 + 4x - \alpha$, $x > 2$, is _____

[JEE Main 2026 (Online) 24th January Morning Shift]

Scan or tap for the full solution

Q.72 Let a line L passing through the point P(1, 1, 1) be perpendicular to the lines $\frac{x-4}{4} = \frac{y-1}{1} = \frac{z-1}{1}$ and $\frac{x-17}{1} = \frac{y-71}{1} = \frac{z}{0}$. Let the line L intersect the yz-plane at the point Q. Another line parallel to L and passing through the point S(1, 0, − 1) intersects the yz-plane at the point R. Then the square of the area of the parallelogram PQRS is equal to _____.

[JEE Main 2026 (Online) 24th January Morning Shift]

Scan or tap for the full solution

Q.73 The number of 3 × 2 matrices A, which can be formed using the elements of the set
{ − 2, − 1, 0, 1, 2} such that the sum of all the diagonal elements of A^TA is 5, is _____

[JEE Main 2026 (Online) 24th January Morning Shift]

Scan or tap for the full solution

Q.74 Let a differentiable function f satisfy the equation $\int_0^{36} f\left(\frac{tx}{36}\right)dt = 4\alpha f(x)$. If y = f(x) is a standard parabola passing through the points (2, 1) and (−4, β), then β^α is equal to _____.

[JEE Main 2026 (Online) 24th January Morning Shift]

Scan or tap for the full solution

Q.75 The number of numbers greater than 5000, less than 9000 and divisible by 3, that can be formed using the digits 0, 1, 2, 5, 9, if the repetition of the digits is allowed, is _____

[JEE Main 2026 (Online) 24th January Morning Shift]

Scan or tap for the full solution

ANSWER KEY

Section A (MCQ) — 60 questions

Ques.	1	2	3	4	5	6	7	8	9	10	11
Ans.	**3**	**1**	**1**	**1**	**3**	**3**	**3**	**2**	**4**	**3**	**1**
Ques.	12	13	14	15	16	17	18	19	20	21	22
Ans.	**3**	**4**	**2**	**4**	**4**	**1**	**4**	**1**	**4**	**2**	**3**
Ques.	23	24	25	26	27	28	29	30	31	32	33
Ans.	**1**	**3**	**3**	**1**	**4**	**3**	**3**	**4**	**3**	**1**	**4**
Ques.	34	35	36	37	38	39	40	41	42	43	44
Ans.	**1**	**4**	**2**	**3**	**2**	**2**	**4**	**1**	**2**	**1**	**4**
Ques.	45	46	47	48	49	50	51	52	53	54	55
Ans.	**1**	**2**	**2**	**4**	**1**	**3**	**3**	**1**	**3**	**1**	**1**
Ques.	56	57	58	59	60						
Ans.	**3**	**1**	**4**	**4**	**4**						

Section B (Numerical) — 15 questions

Ques.	61	62	63
Ans.	**210**	**64**	**125**
Ques.	64	65	66
Ans.	**160**	**3730 or 6460**	**54**
Ques.	67	68	69
Ans.	**111**	**4**	**15**
Ques.	70	71	72
Ans.	**12**	**4**	**6**
Ques.	73	74	75
Ans.	**312**	**64**	**42**